All rights reserved. No part of this publication may be reproduced, distributed, or transmitted in any form or by any means, electronic, mechanical, photocopying, recording or otherwise, or stored in any retrieval system of any nature without the permission of cracku.in, application for which shall be made to support@cracku.in

Downloaded from cracku.in

SSC CHSL 24th May 2022 Shift-3

English Language

1. **The following sentence has been split into four segments. Identify the segment that contains a grammatical error.**
   Rahul sings / very sweet / when he is / in a good mood.

A very sweet

B when he is

C in a good mood

D Rahul sings

Answer: A

2. **Select the most appropriate option to fill in the blank.**
   My grandfather was a farmer and he _____three acres of land

A cultivated

B advanced

C grown

D cultured

Answer: A

3. **Select the most appropriate meaning of the given idiom.**
   Lose your touch

A Doing someone a favour in hopes that the favour will be returned

B To be passed from one person to another

C Not being as successful as previously

D Something being very difficult to find

Answer: C

4. **The following sentence has been split into four segments. Identify the segment that contains a grammatical error.**
   She had resign / from the / post before / he apologised.

A She had resign

B he apologised

C post before

D from the

Answer: A

SSC CHSL Free Mock Test

Downloaded from cracku.in

5. **Select the most appropriate synonym of the given word.**
Bafflement

A Confusion

B Pleasure

C Clarity

D Cleanliness

Answer: A

6. **Select the most appropriate ANTONYM of the given word.**
Praise

A celebrate

B Condemn

C hail

D Secure

Answer: B

7. **Select the most appropriate option that can substitute the underlined segment in the given sentence.**
We want to divide the expenses <u>between</u> the three of us.

A at

B among

C from

D for

Answer: B

SSC CHSL Prevoius Papers (DOWNLOAD PDF)

8. **Select the most appropriate meaning of the given idiom.**
At one's elbow

A Next to someone

B Far away

C Strong grip

D Strong bond

Answer: A

9. **Select the most appropriate synonym of the given word.**
Confront

A Mingle

Downloaded from cracku.in

B Conceal

C Challenge

D Scheme

Answer: C

10. **The following sentence has been split into four segments. Identify the segment that contains a grammatical error.**
After / a long and fun-filled day, / the children / slept themselves peacefully.

A a long and fun-filled day

B slept themselves peacefully

C the children

D After

Answer: B

SSC CGL Previous Papers (DOWNLOAD PDF)

11. **Select the INCORRECTLY spelt word.**

A Laxuryous

B Innocent

C Zealous

D Judicial

Answer: A

12. **Select the option that can be used as a one-word substitute for the underlined group of words**
Geeta is doubtful about getting hired as she is <u>inexperienced at this job.</u>

A Professional

B Expert

C Ace

D Novice

Answer: D

13. **Parts of a sentence are given below in jumbled order. Arrange the parts in the correct order to form a meaningful sentence.**
a) is credited with saying
b) do not dry your feet
c) If you want to leave your footprint on the sands of time,
d) Dr. APJ Abdul Kalam, former President of India

A d,c,a,b

B d,a,c,b

C c,a,b,d

Downloaded from cracku.in

D a,b,c,d,

Answer: B

SSC CGL Free Mock Test (Latest Pattern)

14. **Select the INCORRECTLY spelt word.**

A Arguement

B Performance

C Valuable

D Secretary

Answer: A

15. **Select the most appropriate option to fill in the blank.**
The writer declares that _____ children of their childhood is a criminal act.

A robbing

B robbed

C rob

D to rob

Answer: A

16. **Select the most appropriate ANTONYM of the given word.**
Detrimental

A Baseless

B Harmless

C Senseless

D Meaningless

Answer: B

SSC CHSL Important Questions and Answers (Download PDF)

17. **Select the most appropriate meaning of the given idiom.**
Blow up

A To suffice

B To live up greatly

C To destroy by an explosion

D To stand upright

Answer: C

Downloaded from cracku.in

18. **Select the most appropriate ANTONYM of the given word.**
Dwarf

A Measurable

B Medium

C Tiny

D Giant

Answer: D

19. **From among the words given in bold, select the INCORRECTLY spelt word in the following sentence.**
Small drops trickled down the red and yellow tassels of cannopies and dampened the heads of little boys.

A cannopies

B tassels

C dampened

D trickled

Answer: A

SSC CHSL Study Material

20. **In the following passage, some words have been deleted. Read the passage carefully and select the most appropriate option to fill in each blank. When we believe that our mind is thinking _____ thoughts at the same time, what actually is happening is that _____ thoughts are _____ in such quick _____ so as to seem simultaneous**

A homogenous, measurable, unchanging, velocity

B challenging, limited, fixed, interruption

C multiple, myriad, alternating, succession

D uniform, countable, altering, ramification

Answer: B

Instructions [21 - 25]

In the following passage, some words have been deleted. Read the passage carefully and select the most appropriate option to fill in each blank.

Competition is a necessary prospect for (1)_____ individuals with particular qualities, but only those who can (2)_____ their minds to work, work hard every day, and prove themselves will be able to (3)_____ this arduous battle. It's a never-ending race to the finish line, and only those who put in the effort and dedication will make it to the end. The outcome of any exam does not (4)_____ on the last day, during your paper — your success is ensured with every morning that you put in work. Students must be aware of the tough environment they are entering and prepare (5)_____ in order to improve their chances.

21. **Select the most appropriate option to fill in blank number 1.**

A distinguished

B distinguishes

C distinguishing

Downloaded from cracku.in

D distinguish

Answer: C

22. **Select the most appropriate option to fill in blank number 2.**

A get

B divert

C made

D put

Answer: D

SSC CHSL Free App

23. **Select the most appropriate option to fill in blank number 3.**

A overcome

B overload

C overpaid

D overjoyed

Answer: A

24. **Select the most appropriate option to fill in blank number 4.**

A awake

B arise

C arrive

D abase

Answer: A

25. **Select the most appropriate option to fill in blank number 5.**

A reluctantly

B consequently

C accordingly

D exponentially

Answer: A

Daily Free SSC Practice Set

General Intelligence

Downloaded from cracku.in

26. **Which of the following numbers will replace the question mark (?) in the given series?**
15, 27, 12, ?, 9, 33

A 29

B 18

C 26

D 30

Answer: A

Free SSC Study Material (18,000 Solved Questions)

27. **Which of the following numbers will replace the question mark (?) in the given series?**
13,14,23,48,97,178,?

A 259

B 278

C 269

D 299

Answer: D

28. **A paper is folded and cut as shown below. How will it appear when unfolded?**

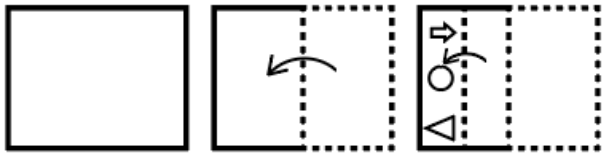

A

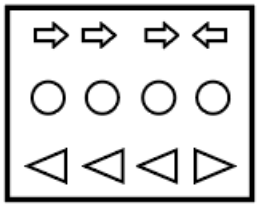

B

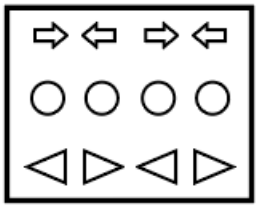

C

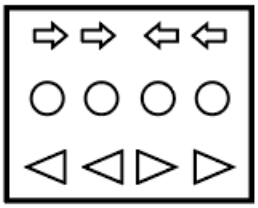

Downloaded from cracku.in

D 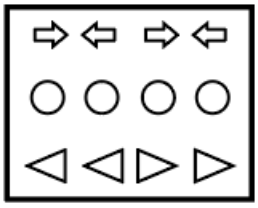

Answer: B

29. **Study the given pattern carefully and select the number that can replace the question mark (?) in it.**
First row- 3, 43, 4
Second row- 6, 241, 5
Third row- 2, ?, 11
(NOTE: Operations should be performed on the whole numbers, without breaking down the numbers into its constituent digits. E.g. 13 - Operations on 13 such as adding /deleting /multiplying etc. to 13 can be performed. Breaking down 13 into 1 and 3 and then performing mathematical operations on 1 and 3 is NOT allowed)

A 173

B 192

C 137

D 129

Answer: D

1500+ Very Important Free SSC Solved Questions

30. **How many triangles, are there in the given figure?**



A 22

B 24

C 20

D 18

Answer: C

31. **Select the option that is related to the third term in the same way as the second term is related to the first term and the sixth term is related to the fifth term.**
16 : 69 :: 24 : ? :: 31 : 144

A 109

Downloaded from cracku.in

B 121

C 116

D 105

Answer: A

32. **Which letter cluster will replace the question mark (?) to complete the given series?**
WFBI, UCWB, SZRU, ?

A QWMN

B QXNN

C QWNN

D QXMN

Answer: A

SSC Exam Update Videos & Free Study Material (YouTube Channel)

33. **The second number in the given number pairs is obtained by performing certain mathematical operation(s) on the first number. The same operation(s) are followed in all the number pairs except one. Find that odd number pair.**

A 16:1024

B 14:784

C 18:1620

D 12:576

Answer: C

34. **If A denotes '+', B denotes '×', C denotes '−' and D denotes '÷', then what will come in place of '?' in the following equation?**
(13 B 9) D 3 A (14 D 7) B 6 C 21 A (32 B 2) = ?

A 96

B 100

C 112

D 94

Answer: D

35. **Which of the following numbers will replace the question mark (?) in the given series?**
19, 38, 35, ?, 135, 810

A 146

B 142

C 137

D 140

Answer: D

Downloaded from cracku.in

Latest Job Updates on Telegram - Join here

36. **Select the option that is related to the fifth term in the same way as the second term is related to the first term and the fourth term is related to the third term.**
NUMBER : UNNYRE :: MOTHER : OMGSRE :: FINGER : ?

A IFDHRE

B IFGNRE

C IFMTRE

D IFTMRE

Answer: C

37. **In a certain code language, 'ADVISORY' is written as 'BFYMRMOU', and 'CHAMPION' is written as 'DJDQOGLJ'. How will 'DESIGNER' be written in that language?**

A EGVNFLCN

B EGUMFMCN

C EGVMFLBN

D EGVNFLBN

Answer: C

38. **Select the option that is related to the fifth number in the same way as the second number is related to the first number and the fourth number is related to the third number.**
24 : -192 :: -31 : 248 :: -18 : ?

A −152

B −146

C 148

D 144

Answer: D

Join SSC Daily Quiz Telegram Group

39. **Select the correct mirror image of the given combination when the mirror is placed at XY as shown.**

A

B

Downloaded from cracku.in

C 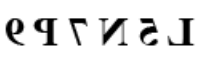

D

Answer: A

40. **Which of the following letter-clusters will replace the question mark (?) in the given series to make it logically complete?**
WVE, UTG, SRI, QPK, ?

A MON

B MNO

C NMO

D ONM

Answer: D

41. **Select the correct mirror image of the given combination when the mirror is placed at MN as shown.**



A 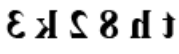

B 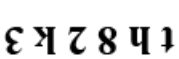

C 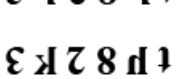

D 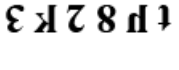

Answer: A

42. **In a certain code language, 'KITCHEN' is written as 'LHUBIDO', and 'HUSBAND' is written as 'ITTABME'. How will 'ELEMENT' be written in that language?**

A FKFLFMU

B FKFLFNU

C FJFLGNV

D FKGLFNU

Answer: A

43. **In a certain code language, “FAMOUS” is written as “AFOMSU”, and “FINGER” is written as “IFGNRE”. How will “INVEST” be written in that language?**

A NIVETS

B NEIVTS

C NIEVST

Downloaded from cracku.in

D NIEVTS

Answer: D

44. **Three statements are given, followed by three conclusions numbered I, II and III. Assuming the statements to be true, even if they seem to be at variance with commonly known facts, decide which of the conclusions logically follow(s) from the statements.**

Statements:
Some butters are honeys.
Some honeys are breads.
All breads are jams.

Conclusions:
I.Some jams are honeys.
II.All honeys are butters.
III.Some jams are butters.

A Only conclusions I and II follow

B 2. Only conclusion II follows

C 3. Only conclusions I and III follow

D 4. Only conclusion I follows

Answer: D

SSC CHSL Free Mock Test

45. **If 21st June 2007 was a Thursday, then what was the day of the week on 21st June 2011?**

A Wednesday

B Monday

C Sunday

D Tuesday

Answer: D

46. **Select the correct mirror image of the given combination when the mirror is placed at MN as shown.**

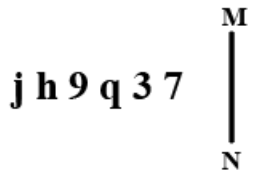

A 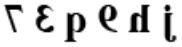

B 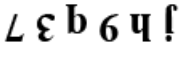

C 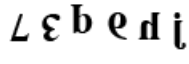

D

Answer: A

Downloaded from cracku.in

47. **Select the option that represents the correct order of the given words as they would appear in an English dictionary.**
1.Adequate
2. Adoption
3. Addiction
4. Abduction
5. Advertisement

A 4,3,1,2,5

B 3,2,4,1,5

C 3,1,4,2,5

D 4,2,1,3,5

Answer: A

SSC CHSL Prevoius Papers (DOWNLOAD PDF)

48. **Two different positions of the same dice are shown, the six faces of which are numbered from 1 to 6. Select the number that will be on the face opposite to the one showing '3 '.**

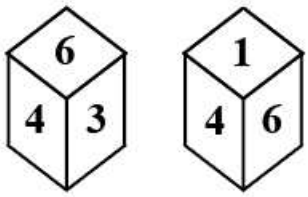

A 4

B 1

C 6

D 2

Answer: B

49. **Study the given pattern carefully and select the number that can replace the question mark (?) in it.**
First row- 9, 21, 124
Second row- 11, 25, 148
Third row- 17, ?, 220
(NOTE: Operations should be performed on the whole numbers, without breaking down the numbers into its constituent digits. E.g. 13 - Operations on 13 such as adding /deleting /multiplying etc. to 13 can be performed. Breaking down 13 into 1 and 3 and then performing mathematical operations on 1 and 3 is NOT allowed)

A 34

B 30

C 35

D 37

Answer: D

50. **The second number in the given number pairs is obtained by performing certain mathematical operation(s) on the first number. The same operation(s) are followed in all the number pairs, EXCEPT one. Find that odd number pair.**

Downloaded from cracku.in

A 361 : 332

B 533 : 504

C 440 : 411

D 520 : 481

Answer: D

SSC CGL Previous Papers (DOWNLOAD PDF)

Quantitative Aptitude

51. **The value of** $(4^3+4) \div [5^2-(7^2-41)]$

A 8

B 17

C 5

D 4

Answer: D

SSC CGL Free Mock Test (Latest Pattern)

52. **The fourth proportional to the numbers 5, 6 and 8 is:**

A 9.8

B 9.6

C 9

D 9.5

Answer: B

53. **To pack a set of books, Gautam got cartons of a certain height that were 48 inches long and 27 inches wide. If the volume of such a carton was 22.5 cubic feet, what was the height of each carton? [Use 1 foot = 12 inches.]**

A 36 inches

B 32.5 inches

C 30 inches

D 32 inches

Answer: C

54. **5 kg of ₹18 per kg wheat is mixed with 2 kg of another type of wheat to get a mixture costing ₹20 per kg. Find the price (per kg) of the costlier wheat.**

A ₹27

Downloaded from cracku.in

B ₹25

C ₹29

D ₹30

Answer: B

SSC CHSL Important Questions and Answers (Download PDF)

55. **If $\cot 75^\circ = 2 - \sqrt{3}$. Find the value of $\cot 15^\circ$.**

A $2 - \sqrt{3}$

B $2 + \sqrt{3}$

C $\sqrt{3} + 1$

D $\sqrt{3} - 1$

Answer: B

56. **In a government scheme, if an electricity bill is paid before the due date, one gets a reduction of 5% on the amount of the bill. By paying the bill before the due date, a person got a reduction of ₹20. The amount of his electricity bill was:**

A ₹440

B ₹400

C ₹520

D ₹420

Answer: B

57. **A shopkeeper earns a profit of 12% on selling a book at 10% discount on the printed price. The ratio of the cost price to the printed price is:**

A 38 : 55

B 45 : 56

C 55 : 38

D 56 : 45

Answer: B

SSC CHSL Study Material

58. **A thief was spotted by a policeman from a distance of 225 metres. When the policeman started the chase, the thief also started running. If the speed of the thief was 11 km/h and that of the policeman was 13 km/h, how far would the thief have run, before the policeman caught up with him?**

A 1237.5 metres

B 1137.5 metres

Downloaded from cracku.in

C 1357.5 metres

D 1256.5 metres

Answer: A

59. **Which of the following is divisible by 3?**

A 7345932

B 5439763

C 3642589

D 3262735

Answer: A

60. **At a certain rate of interest compounded annually, a sum amounts to ₹10,890 in 2 years and to ₹11,979 in 3 years. The sum is:**

A ₹9,000

B ₹8,000

C ₹8,500

D ₹9,500

Answer: A

SSC CHSL Free App

61. **The following graph shows the data of the production of electric wire (in thousand tons b three different companies P, and R over the years.**

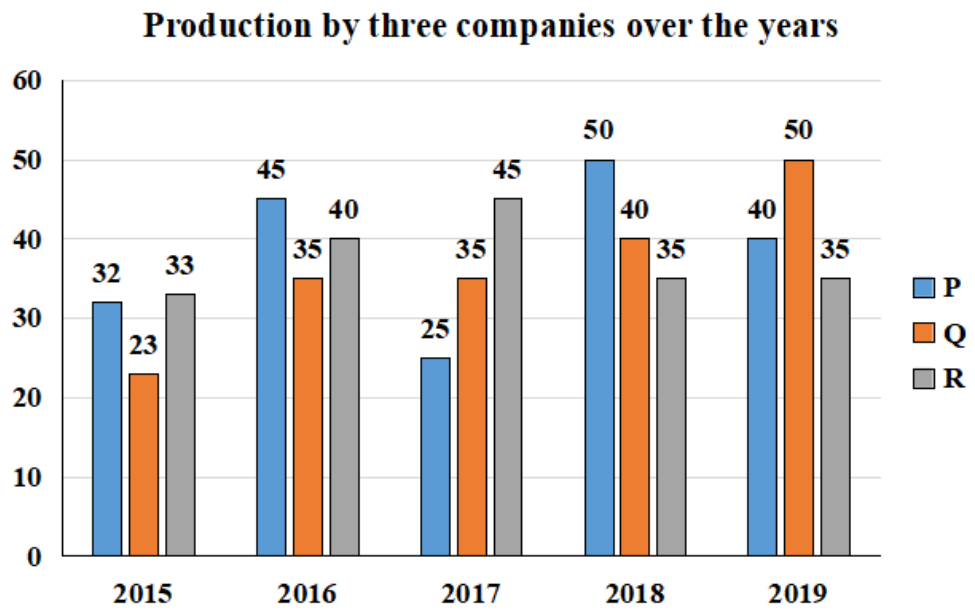

What is the ratio of the average production of Company Pin the period 2017- 2019 to the average production of Company Q in the same period?

A 4 : 5

B 25 : 23

Downloaded from cracku.in

C 23 : 25

D 5 : 4

Answer: C

62. **The following pie chart shows the different coloured dresses worn by 60 students in a college party. Study the pie chart and answer the question that follows.**

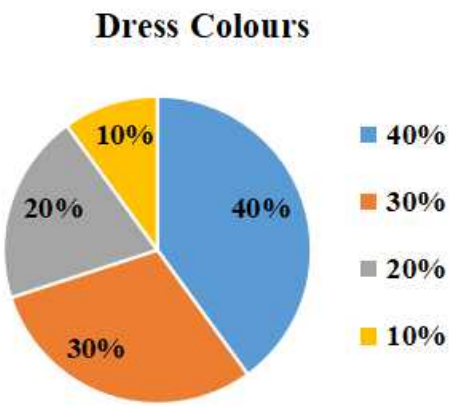

The number of students who wore yellow coloured dress (sector which represents 10%)is:

A 20

B 10

C 6

D 12

Answer: C

63. **In a class, there are 39 students and their average weight is 51 kg. If we include the weight of the teacher, then the average weight becomes 51.2 kg. What is the weight of the teacher?**

A 53 kg

B 59 kg

C 57 kg

D 51 kg

Answer: B

Daily Free SSC Practice Set

64. **A sum of money becomes ₹ 3,364 at a rate of 16% compounded annually for 2 years.**
The sum of money is:

A ₹2,500

B ₹1,800

C ₹3,800

D ₹2,200

Answer: A

Downloaded from cracku.in

65. **If the surface area of a sphere is 1386 cm^2, then find the radius of the sphere.**

A 12.5 cm

B 10.5 cm

C 10 cm

D 12 cm

Answer: B

66. **If the numerator of a fraction be increased by 50% and its denominator be diminished by 28%, the value of the fraction is $\frac{25}{36}$. Find the original fraction.**

A $\frac{1}{5}$

B $\frac{2}{3}$

C $\frac{2}{5}$

D $\frac{1}{3}$

Answer: D

Free SSC Study Material (18,000 Solved Questions)

67. **Simplify** $(957+932)^2 - 4 \times 957 \times 932$.

A 576

B 676

C 529

D 625

Answer: D

68. **If the surface area of a sphere is 64 $\pi\ cm^2$, then the volume of the sphere is:**

A $\frac{241}{3}\ \pi cm^3$

B $\frac{251}{5}\ \pi cm^3$

C $\frac{226}{3}\ \pi cm^3$

D $\frac{251}{3}\ \pi cm^3$

Answer: D

69. **On reducing the marked price of his goods by ₹28, a shopkeeper gains 20%. If the cost price of the article be ₹560 and it is sold at the marked price, what will be the gain per cent?**

A 30%

Downloaded from cracku.in

B 25%

C 20%

D 15%

Answer: B

1500+ Very Important Free SSC Solved Questions

70. **If x + \frac{1}{x} = - 2\sqrt{3}$$, what is the value of $x^{5} + \frac{1}{x^{5}}$$**

A $$- 178\sqrt{3}$$

B $$- 182\sqrt{3}$$

C $$182\sqrt{3}$$

D $$- 180\sqrt{3}$$

Answer: A

71. **Avi and Bindu can complete a project in four and twelve hours, respectively. Avi begins project at 5 a.m., and they work alternately for one hour each. When will the project be completed?**

A 9 a.m.

B 11 a.m.

C 1 p.m.

D 10 a.m.

Answer: B

72. **Two circles having radii 12 cm and 8 cm, respectively, touch each other externally. A common tangent is drawn to these circles which touch the circles at M and N, respectively. What is the length (in cm) of MN?**

A $$8\sqrt{8}$$

B $$8\sqrt{6}$$

C $$6\sqrt{8}$$

D $$6\sqrt{6}$$

Answer: B

SSC Exam Update Videos & Free Study Material (YouTube Channel)

73. **If a+ 2b=27 and $$a^{3} + 8b^{3} = 5427$$, then find the value of 2ab .**

A 176

B 156

C 172

Downloaded from cracku.in

D 149

Answer: A

74. **The following table gives the sales of an electronic chip over 5 years. Find the year in which the sales are equal to the average of the sales over the 5 years.**

Year	2015	2016	2017	2018	2019
Sales (in thousands of rupees)	45	54	57	60	69

A 2018

B 2015

C 2017

D 2016

Answer: C

75. **In an election between two candidates, 80% of the eligible voters cast their votes, 5% of the votes cast were declared invalid. A candidate got 10545 votes, which were 75% of the total valid votes. Find the total number of eligible voters.**

A 17800

B 18500

C 18250

D 18000

Answer: B

Latest Job Updates on Telegram - Join here

General Awareness

76. **In which year was the National Biodiversity Authority, a statutory autonomous body, established under the Ministry of Environment and Forests, Government of India?**

A 2006

B 2000

C 2003

D 2010

Answer: C

Join SSC Daily Quiz Telegram Group

77. **Who won the Major Dhyan Chand Khel Ratna Award 2021 in Para Shooting discipline?**

A Avani Lekhara

Downloaded from cracku.in

B Manu Bhaker

C Gagan Narang

D Apurvi Chandela

Answer: A

78. **Who among the following won the Tansen Samman 2020?**

A Manju Mehta

B Dalchan Sharma

C Ulhas Kashalkar

D Satish Vyas

Answer: D

79. **The term 'checkmate' is used in which of the following sports?**

A Hockey

B Chess

C Cricket

D Badminton

Answer: B

80. **Who among the following received the Sahitya Akademi Award (Non-fiction) for his book 'An Era of Darkness' in 2019?**

A Shashi Tharoor

B Cyrus Mistry

C Jerry Pinto

D Arun Shourie

Answer: A

81. **Shambhu Maharaj was Awarded the Padma Shri for his contribution to which of the following dances in India?**

A Kathak

B Bharatanatyam

C Kuchipudi

D Manipuri

Answer: A

82. **Which of the following is a game played with a racket?**

A Baseball

Downloaded from cracku.in

B Volleyball

C Cricket

D Squash

Answer: D

SSC CHSL Free Mock Test

83. **On $$21^{st}$$ January 2022, three states observed their 50th Statehood Day, which of the following is NOT one amongst these three?**

A Meghalaya

B Nagaland

C Tripura

D Manipur

Answer: B

84. **In optics, the refractive index of a substance is described by the formula n = c/v, where c is:**

A the speed of light in medium

B the centre of curvature

C the radius of the sphere

D the speed of light in vacuum

Answer: D

85. **Which of the following fields is not offered by Kalidas Samman?**

A Classical music

B Classical dance

C Puppetry

D Plastic arts

Answer: C

SSC CHSL Prevoius Papers (DOWNLOAD PDF)

86. **Which is the largest continental shelf in the world?**

A The shelf of India

B The Indian Ocean shelf

C The shelf in the Pacific Ocean

D The Siberian shelf in the Arctic Ocean

Answer: D

Downloaded from cracku.in

87. **For a NBFC- MFI, the maximum variance permitted for individual loans between the minimum and maximum interest rate_____.**

A cannot exceed 4 per cent

B cannot exceed 2 per cent

C cannot be less than 2 per cent

D cannot be less than 4 per cent

Answer: A

88. **Who among the following was the first woman classical dancer in independent India to be nominated as a member to the Rajya Sabha?**

A Vidyagauri Adkar

B Niveditha Arjun

C Rukmini Devi Arundale

D Kalamandalam Kalyanikutty Amma

Answer: C

SSC CGL Previous Papers (DOWNLOAD PDF)

89. **Which French chemist summarised his experiment in 1806, and proved that the mass ratio of elements in a chemical compound is always the same, regardless of the source of the compound?**

A Joseph Proust

B Robert Boyle

C Jacob Berzelius

D John Dalton

Answer: A

90. **Who among the following is credited with single-handedly making the Santoor a popular classical instrument?**

A Shiv Kumar Sharma

B Bhajan Sopori

C Rahul Sharma

D Ulhas Bapat

Answer: A

91. **"The State shall not discriminate against any citizen on grounds only of religion, race, caste, sex, place of birth or any of them". This has been incorporated in:**

A Article 19

B Article 23

Downloaded from cracku.in

C Article 15

D Article 14

Answer: C

SSC CGL Free Mock Test (Latest Pattern)

92. **EM Subramaniam was an exponent of the _____, a musical instrument.**

A mandolin

B guitar

C ghatam

D pakhawaj

Answer: C

93. **Pandit Ravi Shankar, a music legend is famous for which of the following styles of music?**

A Hindustani classical instrumental

B Hindustani classical vocal

C Carnatic classical vocal

D Carnatic classical instrumental

Answer: A

94. **Which of the following is a limestone cave in India?**

A Undavalli Caves

B Varaha Cave

C Borra Caves

D Bhimbetka Caves

Answer: C

SSC CHSL Important Questions and Answers (Download PDF)

95. **Which of the following dancers of Mohiniyattam form of Indian classical dance was given the Devadasi National Award in 2013?**

A Smitha Rajan

B Jayaprabha Menon

C Sunanda Nair

D Gopika Verma

Answer: B

96. **Which of the following adaptations was written by the legendary Indian actor Dev Anand of Hindi films?**

Downloaded from cracku.in

A Romancing with life

B The Satans and the Shadows

C Autobiography of an Actor

D Breaking the Code : My journey in Bollywood

Answer: A

97. **Find the correct chemical formula of nitromethane.**

A $$CH_{3}NO$$

B $$CH_{3}NO_{2}$$

C $$CH_{4}NO_{2}$$

D $$CH_{3}NO_{3}$$

Answer: B

SSC CHSL Study Material

98. **Among the following famous personalities, whose autobiography is 'The Road Ahead'?**

A Elon Musk

B Bill Gates

C Jeff Bezos

D Cristiano Ronaldo

Answer: B

99. **Which of the following is a type of bryophyte that lives in many environments and is characterised by its small, flattened leaves, root-like rhizoids, and peristome?**

A Funaria

B Ulothrix

C Cladophora

D Ulva

Answer: A

100. **Which of the following ministries was held by Dharmendra Pradhan before he became Cabinet Minister of Education, Skill Development and Entrepreneurship in July 2021?**

A Ministry of Information and Broadcasting and Sports

B Ministry of Food Processing Industries

C Ministry of Housing and Urban Development

D Ministry of Petroleum and Natural Gas and Steel

Answer: D

Downloaded from cracku.in

SSC CHSL Free App

SSC CHSL Free Mock Test

SSC CHSL Prevoius Papers (DOWNLOAD PDF)

SSC CGL Previous Papers (DOWNLOAD PDF)

SSC CGL Free Mock Test (Latest Pattern)

SSC CHSL Important Questions and Answers (Download PDF)

SSC CHSL Study Material

SSC CHSL Free App

Daily Free SSC Practice Set

Free SSC Study Material (18,000 Solved Questions)

1500+ Very Important Free SSC Solved Questions

SSC Exam Update Videos & Free Study Material (YouTube Channel)

Latest Job Updates on Telegram - Join here

Join SSC Daily Quiz Telegram Group

Downloaded from cracku.in